MathTownGames

Counting Worksheets to 20

Ages 5-6 | Easy | 8 questions

Name _____ Date _____

Count the shapes. Groups are in rows of five to help you.

1 How many?



Answer: _____

2 How many?



Answer: _____

3 How many?



Answer: _____

4 How many?



Answer: _____

5 How many?



Answer: _____

6 How many?



Answer: _____

7 How many?



Answer: _____

8 How many?



Answer: _____